Name:_____

Step-by-step examples at tangmath.com/puzzles

TANGY TUESDAY™		
PACK	LEVEL	WEEK
1	D	5

Tangy Tuesday
Pack 1

DigiCross · Snake · NumTanga · Kakooma · Equato

Licensed for 2021-22 school year

TANG MATH

© Tang Math LLC

Name:_____

DIGICROSS

Step-by-step examples at tangmath.com/puzzles

TANGY TUESDAY™		
PACK	LEVEL	WEEK
1	D	5

Complete the crossword by filling in a word that fits each clue.



ACROSS

2. 5 thirds - 1 third = ___ thirds
3. 72 is a multiple of ___
5. 4,521 is closest to ___ thousand
6. 132 is ___ times as much as 12
8. .9 = nine ___

DOWN

1. 4/5 is ___ than 3/7
4. 65 ÷ 5
7. 4 x 222 = 800 + ___ + 8
9. 5,999 + 2,999 = 8,998
10. 61 ÷ 11 has remainder ___

Licensed for 2021-22 school year

TANG MATH

© Tang Math LLC

Name:_____

SNAKE

Step-by-step examples at tangmath.com/puzzles

TANGY TUESDAY™		
PACK	LEVEL	WEEK
1	D	5

Fill each empty box, in order, combining the numbers from the previous 2 boxes.

3			÷4				÷2	
×2		+10		×5		-7		×2
-2		×3		-14		×5		-2
	÷2				÷2			6

4	×4				÷2		×2	
		-1		-1				+0
	÷5						÷2	
×3				×3		×5		
	-3		÷2				-14	6

© Tang Math LLC

Name:_____

NUMTANGA

Step-by-step examples at tangmath.com/puzzles

TANGY TUESDAY™		
PACK	LEVEL	WEEK
1	D	5

In each empty box, write the matching value between adjacent cards.

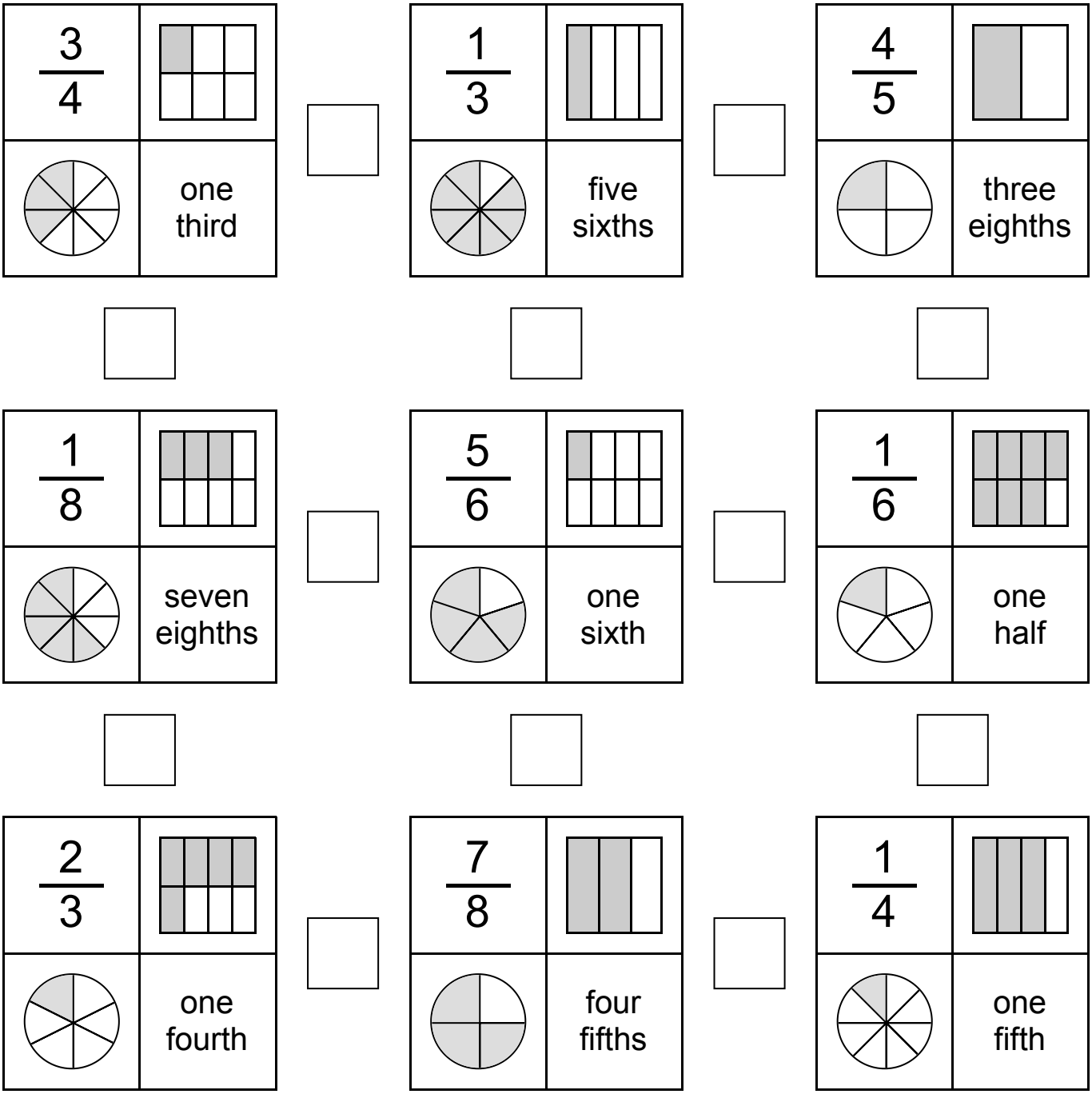

© Tang Math LLC

Name:_____

KAKOOMA

Step-by-step examples at tangmath.com/puzzles

TANGY TUESDAY™		
PACK	LEVEL	WEEK
1	D	5

In each group, circle the one number that is the product of two other numbers.
Write the circled numbers in the final puzzle and solve.

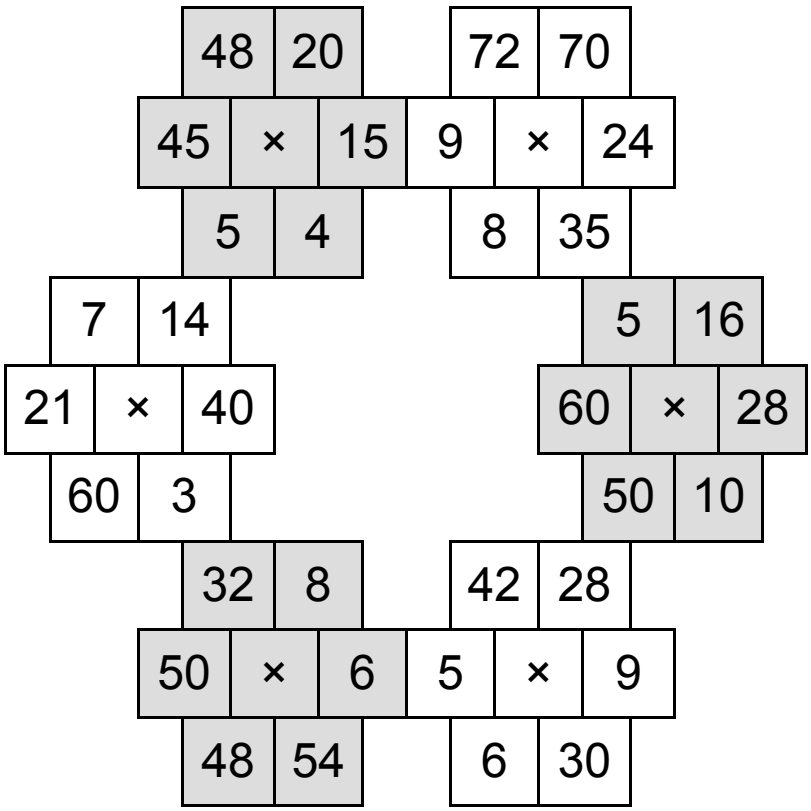

Final Puzzle

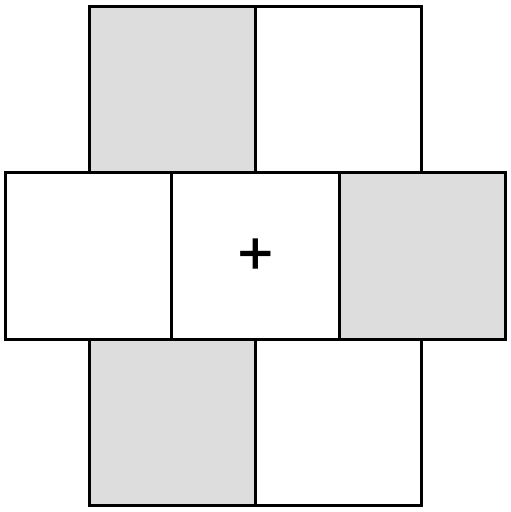

Final Answer



© Tang Math LLC

Name:_____

EQUATO

Step-by-step examples at tangmath.com/puzzles

TANGY TUESDAY™		
PACK	LEVEL	WEEK
1	D	5

Use each number once to complete the equations. Read equations left to right and top to bottom.

NUMBER BANK

1 2 3 4 5 6 7 8

3	+		+	5	=	9
=		+		=		−
	−		=	8	−	
+		=		+		=
	−	6	÷	2	=	4
−		−		−		−
	−		=		×	1

© Tang Math LLC